1 Zeichne diese Dreiecke.

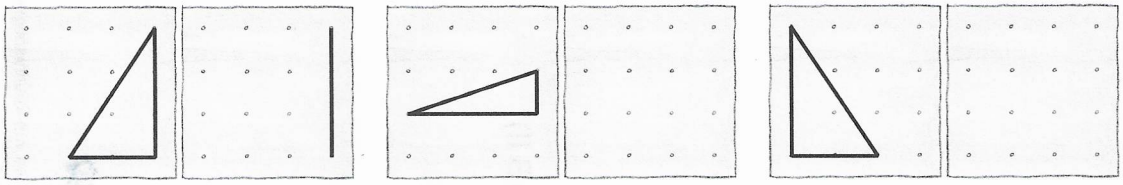

2 Zeichne vier verschiedene Vierecke.



3 Zeichne das Spiegelbild.

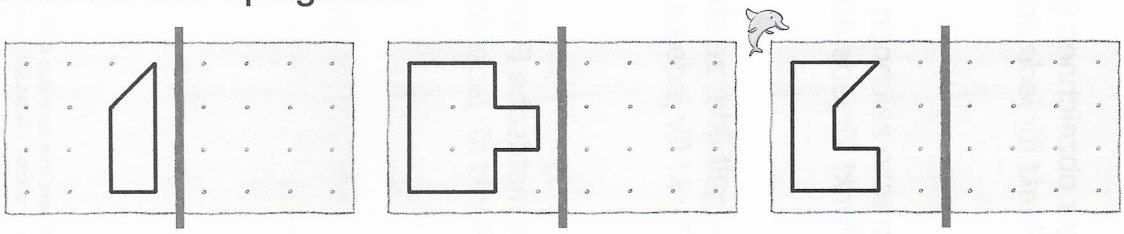

4 Wie viele Formen siehst du?



____ Quadrate ____ Dreiecke ____ Rechtecke

© 2011 *westermann* 978-3-14-**192321**-6 Erfolgskontrollen zu Denken und Rechnen 1